立方体の体積

1辺 × 1辺 × 1辺 で体積を求めましょう。

なまえ _____　　月　日

(1)

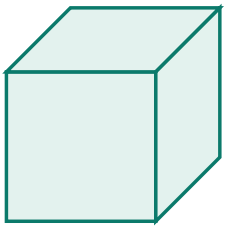

1辺 3cm

しき _____

体積 _____ cm^3

(2)

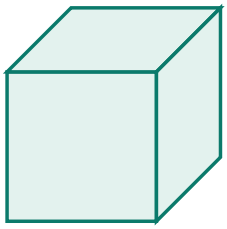

1辺 6cm

しき _____

体積 _____ cm^3

(3)

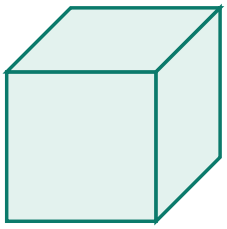

1辺 7cm

しき _____

体積 _____ cm^3

(4)

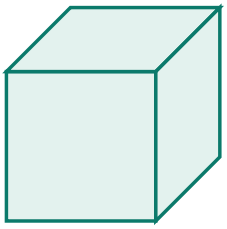

1辺 5cm

しき _____

体積 _____ cm^3

(5)

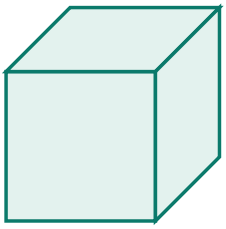

1辺 2cm

しき _____

体積 _____ cm^3

(6)

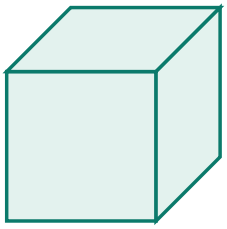

1辺 4cm

しき _____

体積 _____ cm^3

(7)

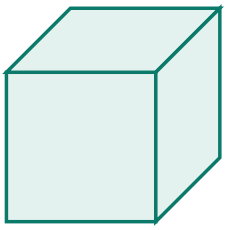

1辺 10cm

しき _____

体積 _____ cm^3

(8)

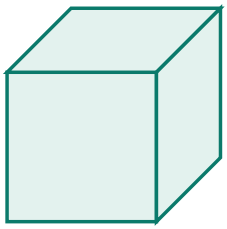

1辺 11cm

しき _____

体積 _____ cm^3

(9)

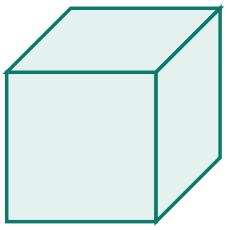

1辺 9cm

しき _____

体積 _____ cm^3

こたえ：立方体の体積

1ページ目の問題の答えです。

(1)

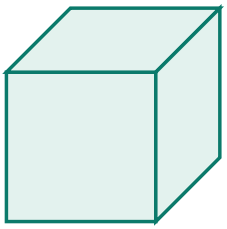

1辺 3cm

3 × 3 × 3 = 27
体積　27 cm^3

(2)

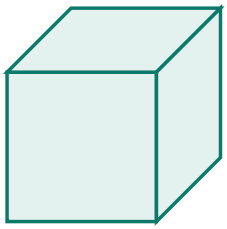

1辺 6cm

6 × 6 × 6 = 216
体積　216 cm^3

(3)

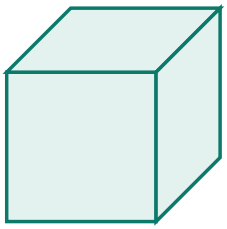

1辺 7cm

7 × 7 × 7 = 343
体積　343 cm^3

(4)

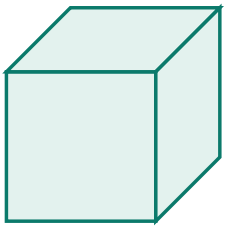

1辺 5cm

5 × 5 × 5 = 125
体積　125 cm^3

(5)

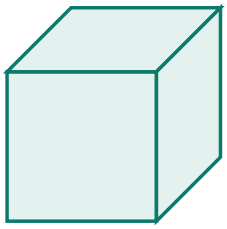

1辺 2cm

2 × 2 × 2 = 8
体積　8 cm^3

(6)

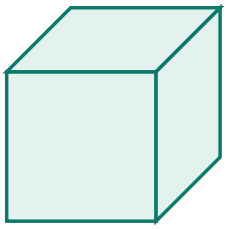

1辺 4cm

4 × 4 × 4 = 64
体積　64 cm^3

(7)

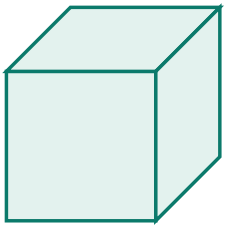

1辺 10cm

10 × 10 × 10 = 1,000
体積　1,000 cm^3

(8)

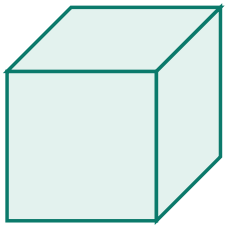

1辺 11cm

11 × 11 × 11 = 1,331
体積　1,331 cm^3

(9)

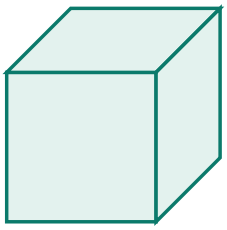

1辺 9cm

9 × 9 × 9 = 729
体積　729 cm^3